EFTERSØGNING EFTER STEFAN!

Stefan er faldet med sin cykel og er kommet slemt til skade. Bjergredningen tager straks af sted for at behandle ham. Men, hvilken af de mange stier skal bjergredningen vælge for at finde Stefan?



BJERG-REGNING

Start i den nederste række
for at klatre op af bjerget. Læg hertil altid de to tal sammen, som er ved siden af hinanden.

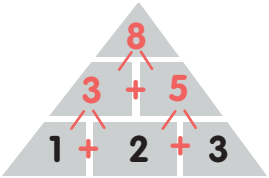

1

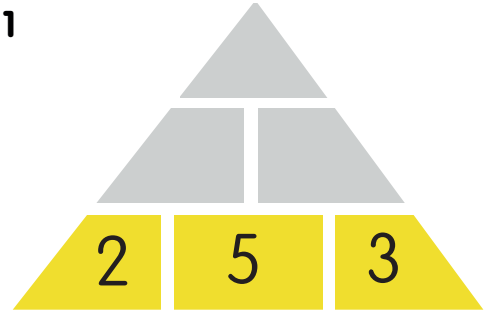

2

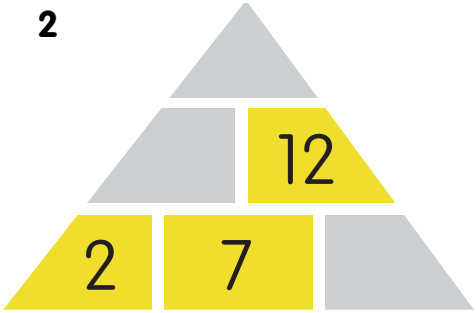

3

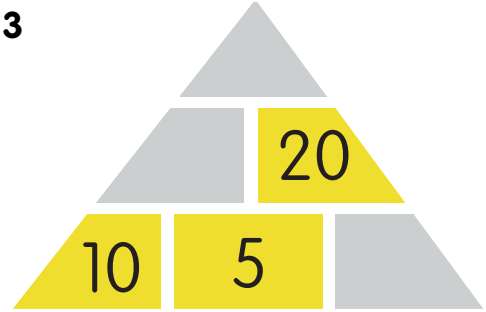

4

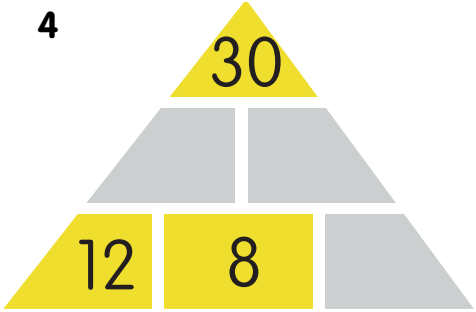

5

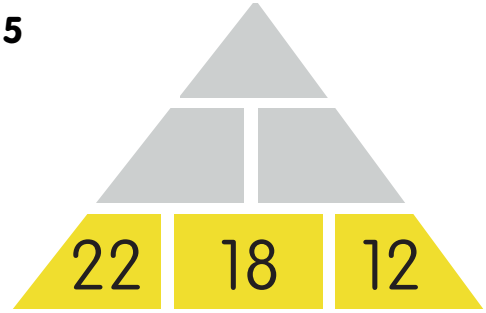

6

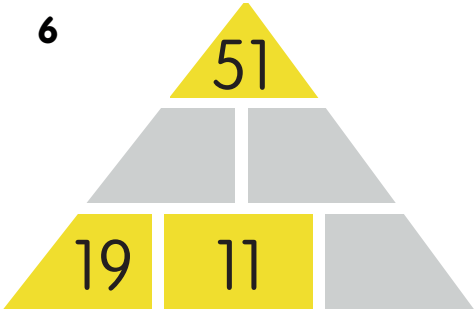

1

2

3

4

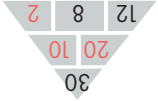

5

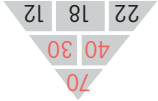

6

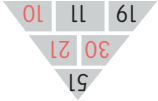

SKYGGEJAGT

Find skyggen, der passer til helikopteren, og lav en cirkel omkring den.